Improper and Mixed Fractions Visual

Name:

Write each amount as a mixed number.

1)

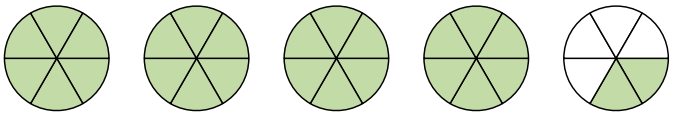

2)

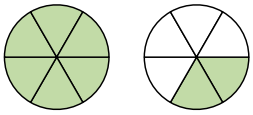

3)

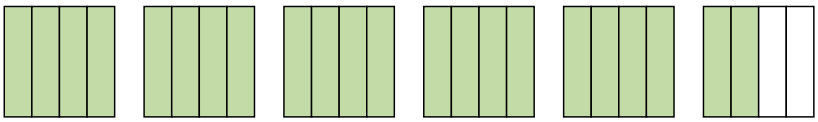

4)



5)

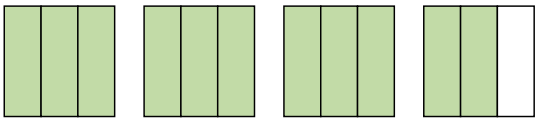

Write each amount as an improper fraction.

6)

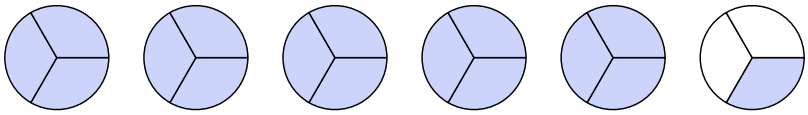

7)

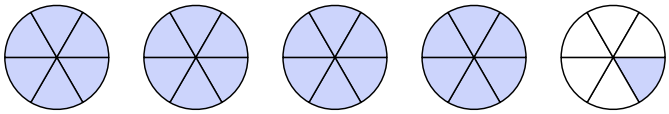

8)

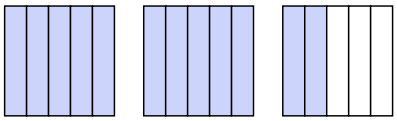

9)

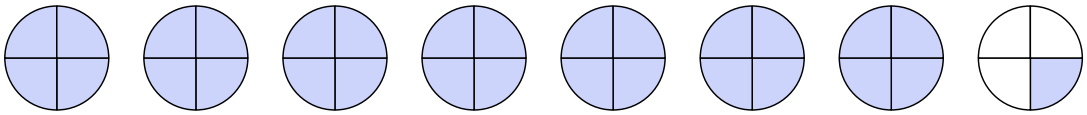

10)

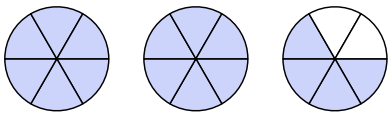

11)

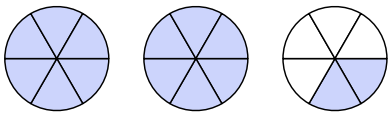

Answers

1. _____
2. _____
3. _____
4. _____
5. _____
6. _____
7. _____
8. _____
9. _____
10. _____
11. _____

1-10	91	82	73	64	55	45	36	27	18	9
11	0									

Improper and Mixed Fractions Visual

Name: **Answer Key**

Write each amount as a mixed number.

1)

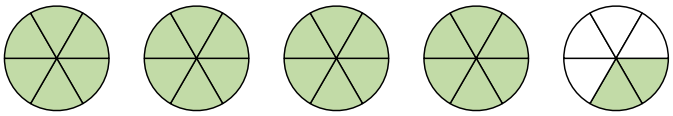

2)

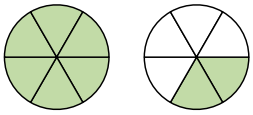

3)

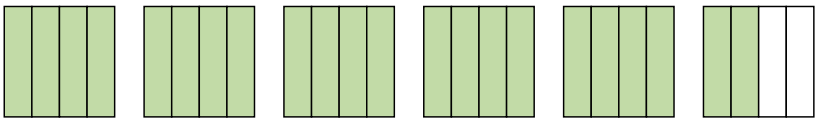

4)



5)

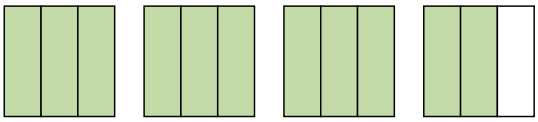

Write each amount as an improper fraction.

6)

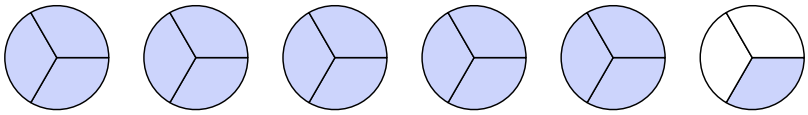

7)

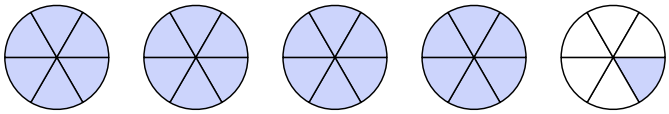

8)

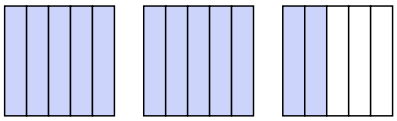

9)

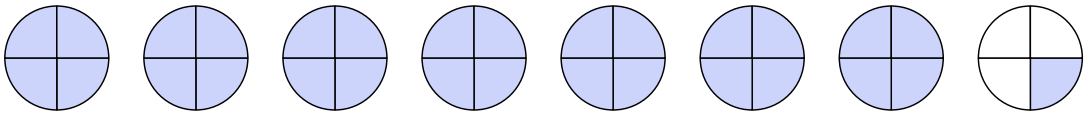

10)

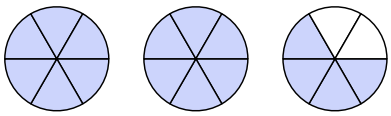

11)

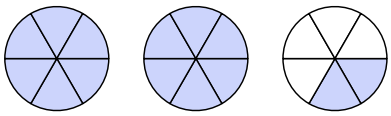

Answers

1. $4\frac{2}{6}$
2. $1\frac{2}{6}$
3. $5\frac{2}{4}$
4. $4\frac{1}{2}$
5. $3\frac{2}{3}$
6. $\frac{16}{3}$
7. $\frac{25}{6}$
8. $\frac{12}{5}$
9. $\frac{29}{4}$
10. $\frac{16}{6}$
11. $\frac{14}{6}$

1-10	91	82	73	64	55	45	36	27	18	9
11	0									